الاسم: _____ التاريخ: _____

# المستوى الإحداثي

أجب عن كل شبكة.

1. 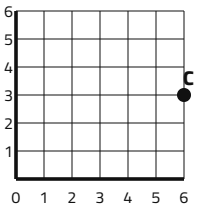


C = _____

2. 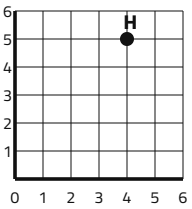


H = _____

3. 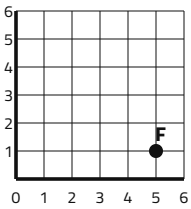


F = _____

4. 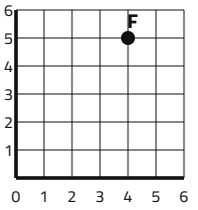


F = _____

5. 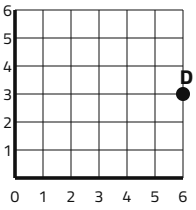


D = _____

6. 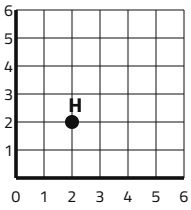


H = _____

7. 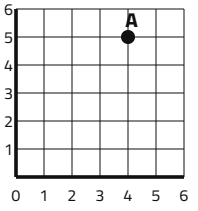


A = _____

8. 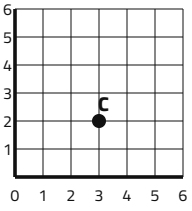


C = _____

9. 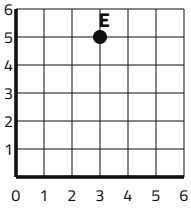


E = _____

# المستوى الإحداثي

مفتاح الإجابات

أجب عن كل شبكة.

.1

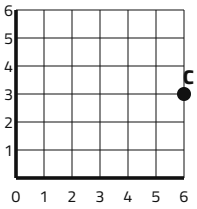


C = (6, 3)

.2

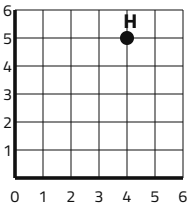


H = (4, 5)

.3

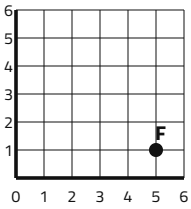


F = (5, 1)

.4

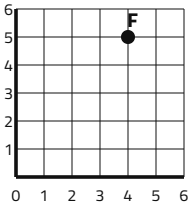


F = (4, 5)

.5

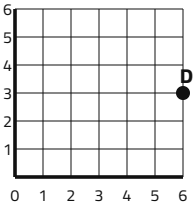


D = (6, 3)

.6

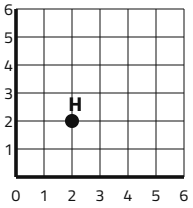


H = (2, 2)

.7

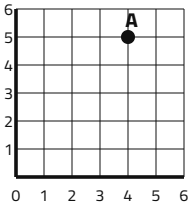


A = (4, 5)

.8

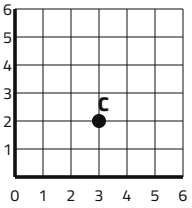


C = (3, 2)

.9

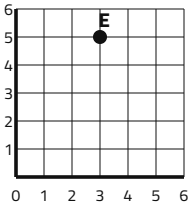


E = (3, 5)