الاسم: _____ التاريخ: _____

# الكسور المصوّرة

اكتب الكسر الذي يمثّله الجزء المظلل.

.1 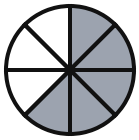

_____

.2 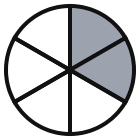

_____

.3 

_____

.4 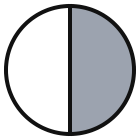

_____

.5 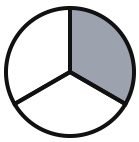

_____

.6 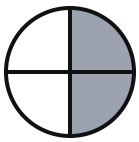

_____

.7 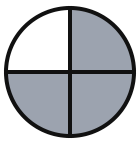

_____

.8 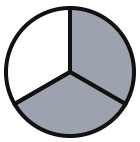

_____

.9 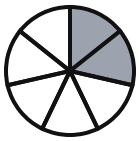

_____

.10 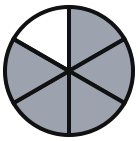

_____

.11 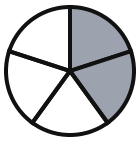

_____

.12 

_____

.13 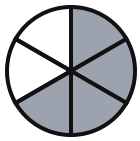

_____

.14 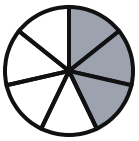

_____

.15 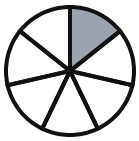

_____

.16 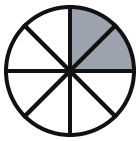

_____

الاسم: _____ التاريخ: _____

# الكسور المصوّرة

اكتب الكسر الذي يمثّله الجزء المظلل.

.1 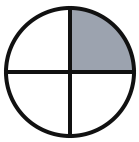

_____

.2 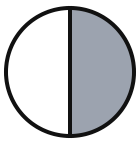

_____

.3 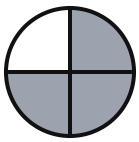

_____

.4 

_____

.5 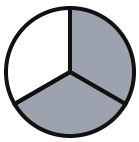

_____

.6 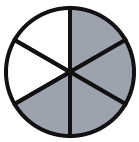

_____

.7 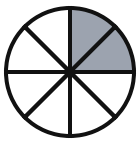

_____

.8 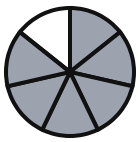

_____

.9 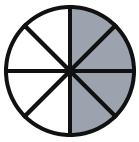

_____

.10 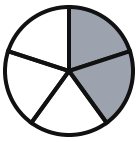

_____

.11 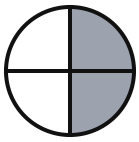

_____

.12 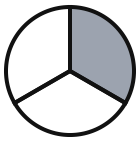

_____

.13 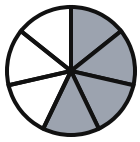

_____

.14 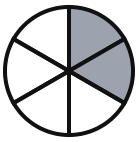

_____

.15 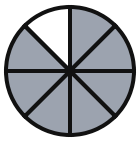

_____

.16 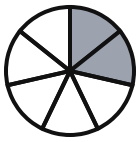

_____

الاسم: _____ التاريخ: _____

# الكسور المصوّرة

اكتب الكسر الذي يمثّله الجزء المظلل.

.1 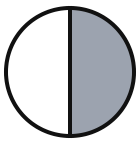

_____

.2 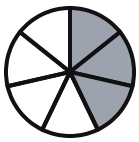

_____

.3 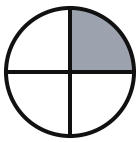

_____

.4 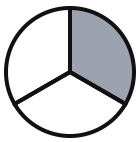

_____

.5 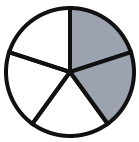

_____

.6 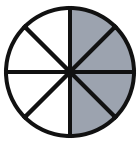

_____

.7 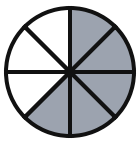

_____

.8 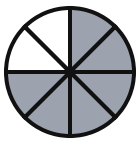

_____

.9 

_____

.10 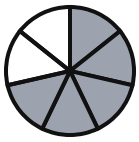

_____

.11 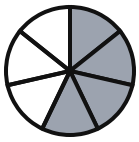

_____

.12 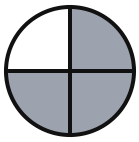

_____

.13 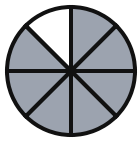

_____

.14 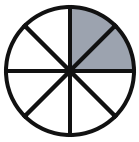

_____

.15 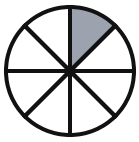

_____

.16 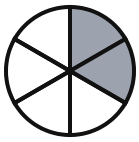

_____

الاسم: _____ التاريخ: _____

# الكسور المصوّرة

اكتب الكسر الذي يمثّله الجزء المظلل.

.1 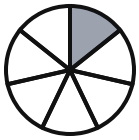

_____

.2 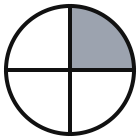

_____

.3 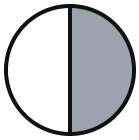

_____

.4 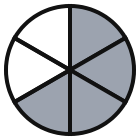

_____

.5 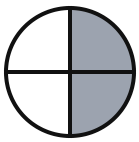

_____

.6 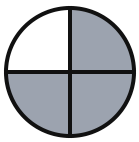

_____

.7 

_____

.8 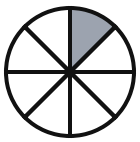

_____

.9 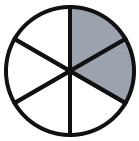

_____

.10 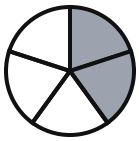

_____

.11 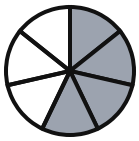

_____

.12 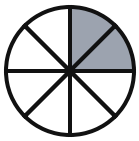

_____

.13 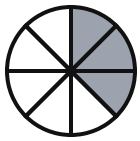

_____

.14 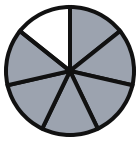

_____

.15 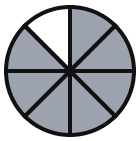

_____

.16 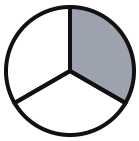

_____

الاسم: _____ التاريخ: _____

# الكسور المصوّرة

اكتب الكسر الذي يمثّله الجزء المظلل.

.1 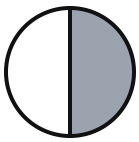

.2 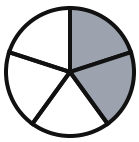

.3 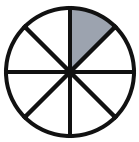

.4 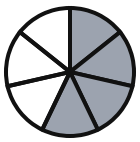

.5 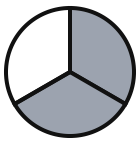

.6 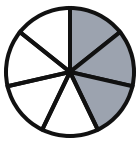

.7 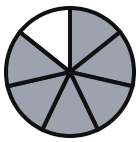

.8 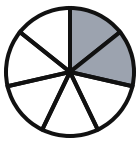

.9 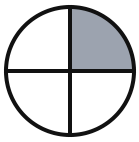

.10 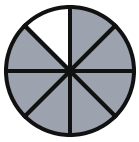

.11 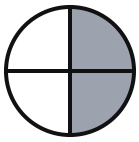

.12 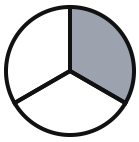

.13 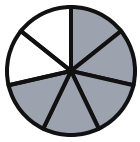

.14 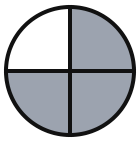

.15 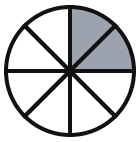

.16 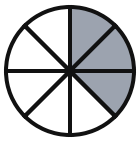

الاسم: _____ التاريخ: _____

# الكسور المصوّرة

اكتب الكسر الذي يمثّله الجزء المظلل.

.1 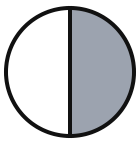 _____

.2 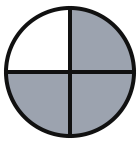 _____

.3 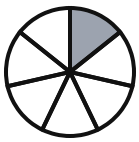 _____

.4 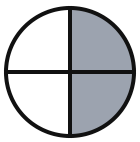 _____

.5 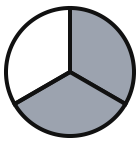 _____

.6 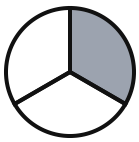 _____

.7 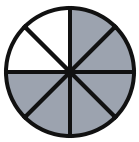 _____

.8  _____

.9 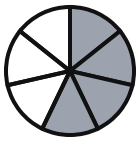 _____

.10 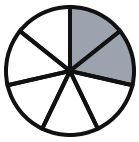 _____

.11 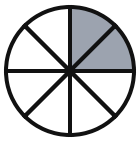 _____

.12 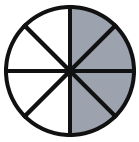 _____

.13 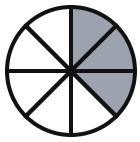 _____

.14  _____

.15 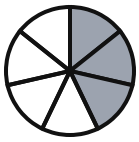 _____

.16 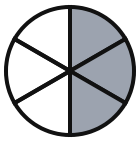 _____

الاسم: _____ التاريخ: _____

# الكسور المصوّرة

اكتب الكسر الذي يمثّله الجزء المظلل.

.1 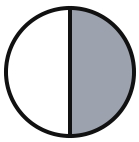

_____

.2 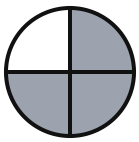

_____

.3 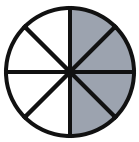

_____

.4 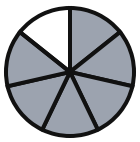

_____

.5 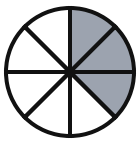

_____

.6 

_____

.7 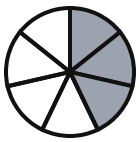

_____

.8 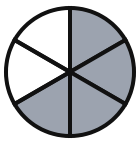

_____

.9 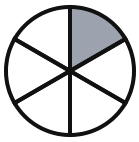

_____

.10 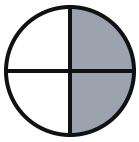

_____

.11 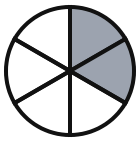

_____

.12 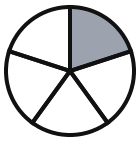

_____

.13 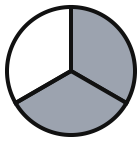

_____

.14 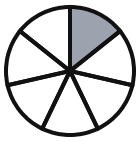

_____

.15 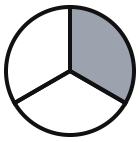

_____

.16 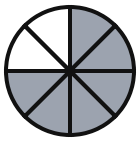

_____

الاسم: _____ التاريخ: _____

# الكسور المصوّرة

اكتب الكسر الذي يمثّله الجزء المظلل.

.1 

_____

.2 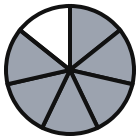

_____

.3 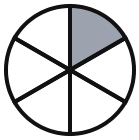

_____

.4 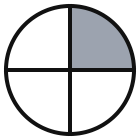

_____

.5 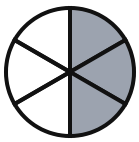

_____

.6 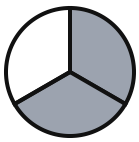

_____

.7 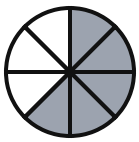

_____

.8 

_____

.9 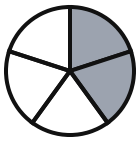

_____

.10 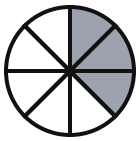

_____

.11 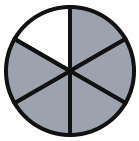

_____

.12 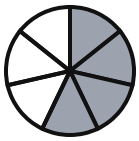

_____

.13 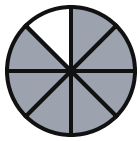

_____

.14 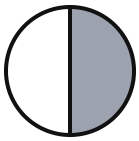

_____

.15 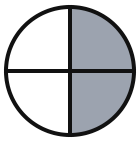

_____

.16 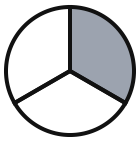

_____

الاسم: _____ التاريخ: _____

# الكسور المصوّرة

اكتب الكسر الذي يمثّله الجزء المظلل.

.1 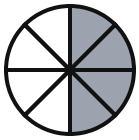

_____

.2 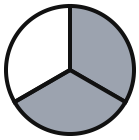

_____

.3 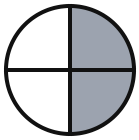

_____

.4 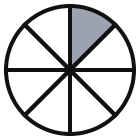

_____

.5 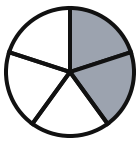

_____

.6 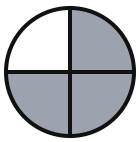

_____

.7 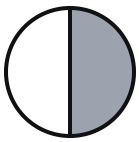

_____

.8 

_____

.9 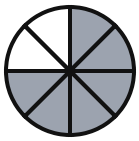

_____

.10 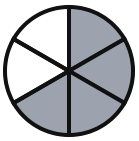

_____

.11 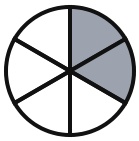

_____

.12 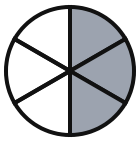

_____

.13 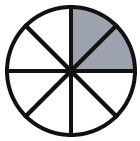

_____

.14 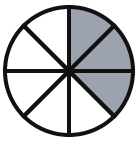

_____

.15 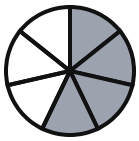

_____

.16 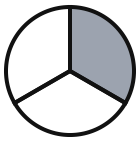

_____

الاسم: _____ التاريخ: _____

# الكسور المصوّرة

اكتب الكسر الذي يمثّله الجزء المظلل.

.1 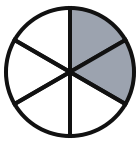

_____

.2 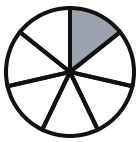

_____

.3 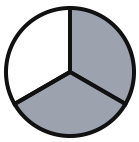

_____

.4 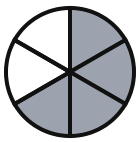

_____

.5 

_____

.6 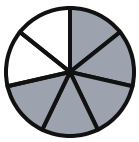

_____

.7 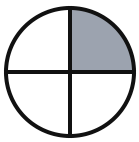

_____

.8 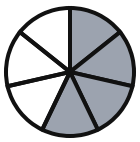

_____

.9 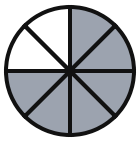

_____

.10 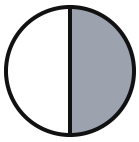

_____

.11 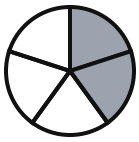

_____

.12 

_____

.13 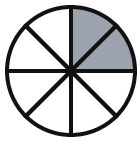

_____

.14 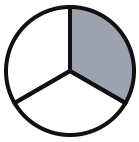

_____

.15 

_____

.16 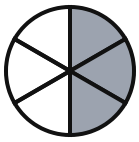

_____

# الكسور المصوّرة

**مفتاح الإجابات**

اكتب الكسر الذي يمثّله الجزء المظلل.

.1 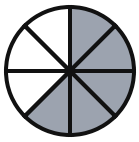

$\frac{5}{8}$

.2 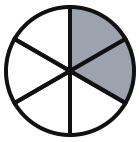

$\frac{2}{6}$

.3 

$\frac{4}{5}$

.4 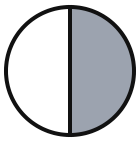

$\frac{1}{2}$

.5 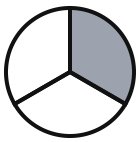

$\frac{1}{3}$

.6 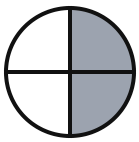

$\frac{2}{4}$

.7 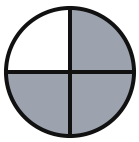

$\frac{3}{4}$

.8 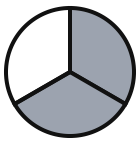

$\frac{2}{3}$

.9 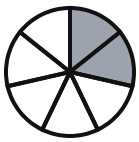

$\frac{2}{7}$

.10 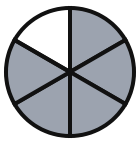

$\frac{5}{6}$

.11 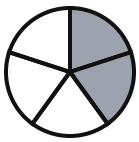

$\frac{2}{5}$

.12 

$\frac{3}{5}$

.13 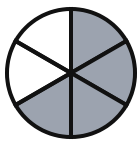

$\frac{4}{6}$

.14 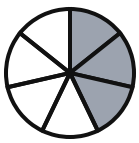

$\frac{3}{7}$

.15 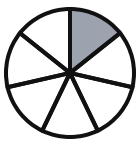

$\frac{1}{7}$

.16 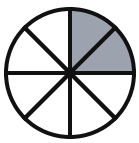

$\frac{2}{8}$

# الكسور المصوّرة

**مفتاح الإجابات**

اكتب الكسر الذي يمثّله الجزء المظلل.

.1 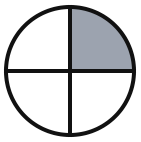

$\frac{1}{4}$

.2 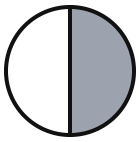

$\frac{1}{2}$

.3 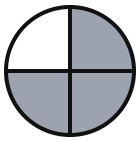

$\frac{3}{4}$

.4 

$\frac{1}{5}$

.5 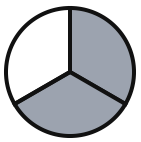

$\frac{2}{3}$

.6 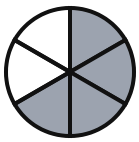

$\frac{4}{6}$

.7 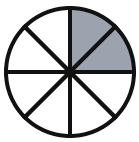

$\frac{2}{8}$

.8 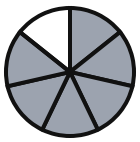

$\frac{6}{7}$

.9 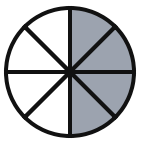

$\frac{4}{8}$

.10 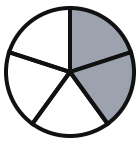

$\frac{2}{5}$

.11 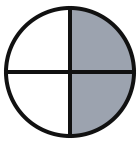

$\frac{2}{4}$

.12 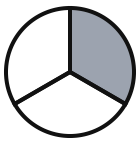

$\frac{1}{3}$

.13 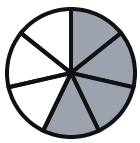

$\frac{4}{7}$

.14 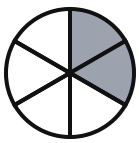

$\frac{2}{6}$

.15 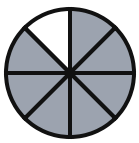

$\frac{7}{8}$

.16 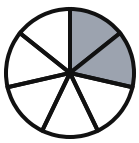

$\frac{2}{7}$

# الكسور المصوّرة

**مفتاح الإجابات**

اكتب الكسر الذي يمثّله الجزء المظلل.

.1 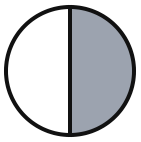

$\frac{1}{2}$

.2 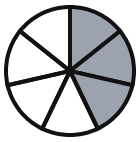

$\frac{3}{7}$

.3 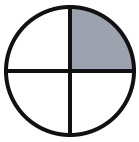

$\frac{1}{4}$

.4 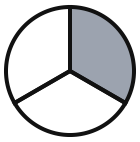

$\frac{1}{3}$

.5 

$\frac{2}{5}$

.6 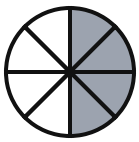

$\frac{4}{8}$

.7 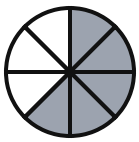

$\frac{5}{8}$

.8 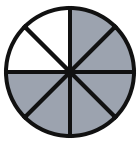

$\frac{6}{8}$

.9 

$\frac{3}{5}$

.10 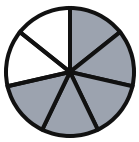

$\frac{5}{7}$

.11 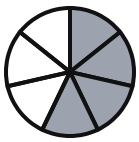

$\frac{4}{7}$

.12 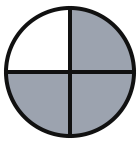

$\frac{3}{4}$

.13 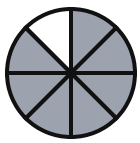

$\frac{7}{8}$

.14 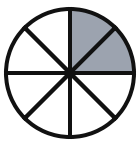

$\frac{2}{8}$

.15 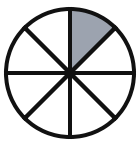

$\frac{1}{8}$

.16 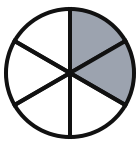

$\frac{2}{6}$

# الكسور المصوّرة

**مفتاح الإجابات**

اكتب الكسر الذي يمثّله الجزء المظلل.

.1 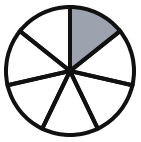

$\frac{1}{7}$

.2 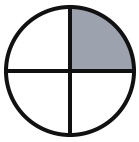

$\frac{1}{4}$

.3 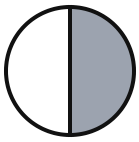

$\frac{1}{2}$

.4 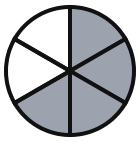

$\frac{4}{6}$

.5 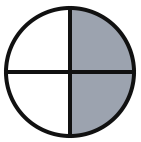

$\frac{2}{4}$

.6 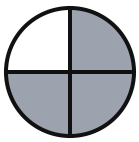

$\frac{3}{4}$

.7 

$\frac{1}{5}$

.8 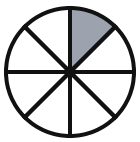

$\frac{1}{8}$

.9 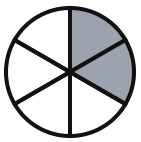

$\frac{2}{6}$

.10 

$\frac{2}{5}$

.11 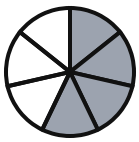

$\frac{4}{7}$

.12 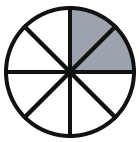

$\frac{2}{8}$

.13 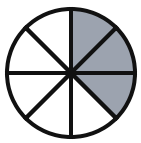

$\frac{3}{8}$

.14 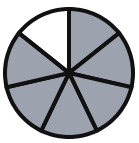

$\frac{6}{7}$

.15 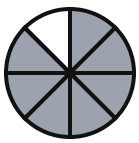

$\frac{7}{8}$

.16 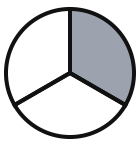

$\frac{1}{3}$

# الكسور المصوّرة

**مفتاح الإجابات**

اكتب الكسر الذي يمثّله الجزء المظلل.

.1 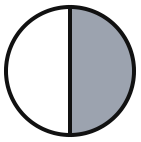

$\frac{1}{2}$

.2 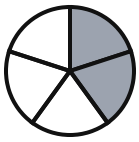

$\frac{2}{5}$

.3 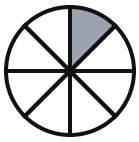

$\frac{1}{8}$

.4 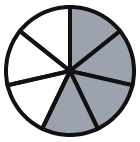

$\frac{4}{7}$

.5 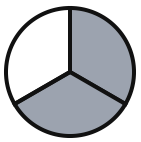

$\frac{2}{3}$

.6 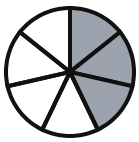

$\frac{3}{7}$

.7 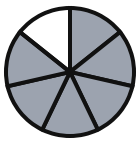

$\frac{6}{7}$

.8 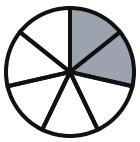

$\frac{2}{7}$

.9 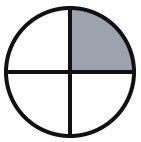

$\frac{1}{4}$

.10 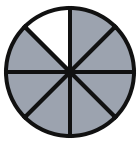

$\frac{7}{8}$

.11 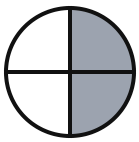

$\frac{2}{4}$

.12 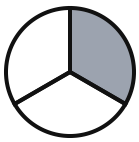

$\frac{1}{3}$

.13 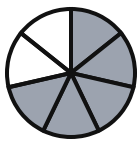

$\frac{5}{7}$

.14 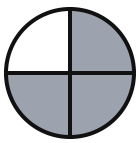

$\frac{3}{4}$

.15 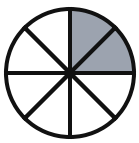

$\frac{2}{8}$

.16 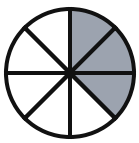

$\frac{3}{8}$

# الكسور المصوّرة

**مفتاح الإجابات**

اكتب الكسر الذي يمثّله الجزء المظلل.

.1 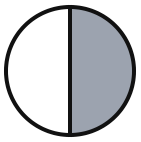

$\frac{1}{2}$

.2 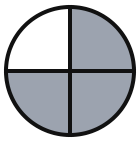

$\frac{3}{4}$

.3 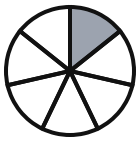

$\frac{1}{7}$

.4 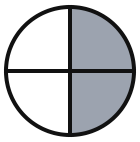

$\frac{2}{4}$

.5 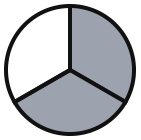

$\frac{2}{3}$

.6 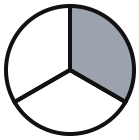

$\frac{1}{3}$

.7 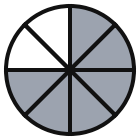

$\frac{6}{8}$

.8 

$\frac{1}{5}$

.9 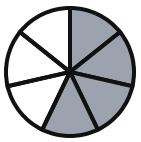

$\frac{4}{7}$

.10 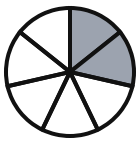

$\frac{2}{7}$

.11 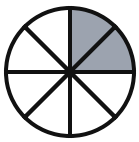

$\frac{2}{8}$

.12 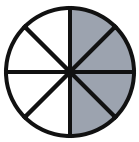

$\frac{4}{8}$

.13 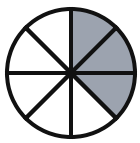

$\frac{3}{8}$

.14 

$\frac{4}{5}$

.15 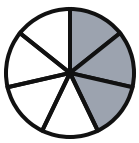

$\frac{3}{7}$

.16 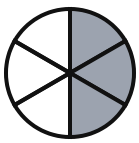

$\frac{3}{6}$

# الكسور المصوّرة

**مفتاح الإجابات**

اكتب الكسر الذي يمثّله الجزء المظلل.

.1 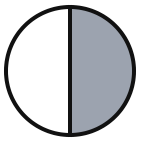

$\frac{1}{2}$

.2 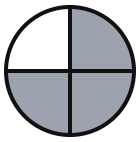

$\frac{3}{4}$

.3 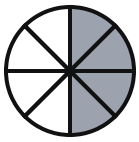

$\frac{4}{8}$

.4 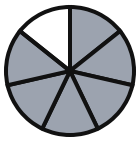

$\frac{6}{7}$

.5 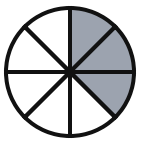

$\frac{3}{8}$

.6 

$\frac{4}{5}$

.7 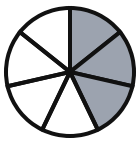

$\frac{3}{7}$

.8 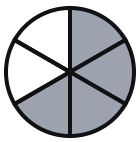

$\frac{4}{6}$

.9 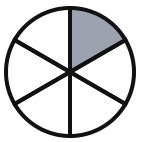

$\frac{1}{6}$

.10 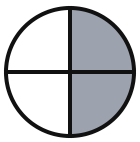

$\frac{2}{4}$

.11 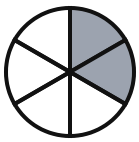

$\frac{2}{6}$

.12 

$\frac{1}{5}$

.13 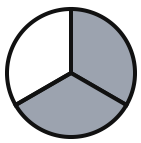

$\frac{2}{3}$

.14 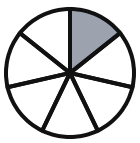

$\frac{1}{7}$

.15 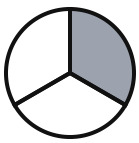

$\frac{1}{3}$

.16 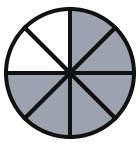

$\frac{6}{8}$

# الكسور المصوّرة

**مفتاح الإجابات**

اكتب الكسر الذي يمثّله الجزء المظلل.

.1 

$\frac{4}{5}$

.2 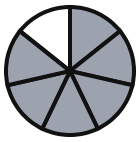

$\frac{6}{7}$

.3 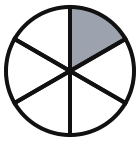

$\frac{1}{6}$

.4 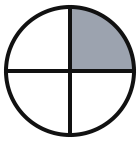

$\frac{1}{4}$

.5 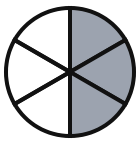

$\frac{3}{6}$

.6 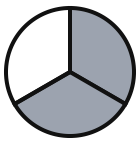

$\frac{2}{3}$

.7 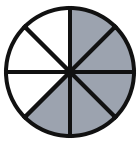

$\frac{5}{8}$

.8 

$\frac{1}{5}$

.9 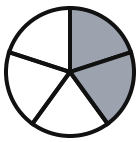

$\frac{2}{5}$

.10 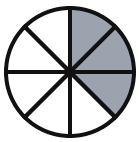

$\frac{3}{8}$

.11 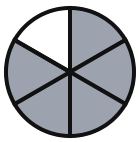

$\frac{5}{6}$

.12 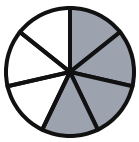

$\frac{4}{7}$

.13 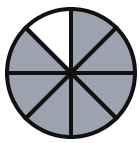

$\frac{7}{8}$

.14 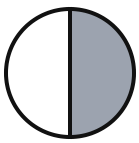

$\frac{1}{2}$

.15 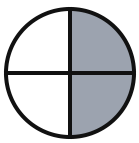

$\frac{2}{4}$

.16 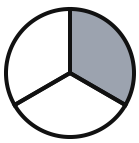

$\frac{1}{3}$

# الكسور المصوّرة

**مفتاح الإجابات**

اكتب الكسر الذي يمثّله الجزء المظلل.

.1 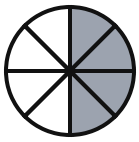

$\frac{4}{8}$

.2 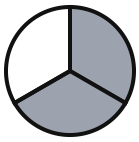

$\frac{2}{3}$

.3 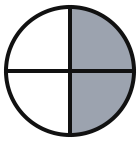

$\frac{2}{4}$

.4 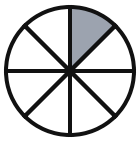

$\frac{1}{8}$

.5 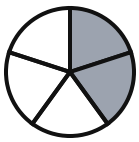

$\frac{2}{5}$

.6 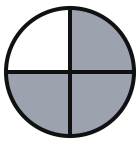

$\frac{3}{4}$

.7 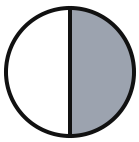

$\frac{1}{2}$

.8 

$\frac{4}{5}$

.9 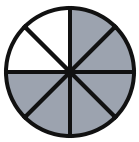

$\frac{6}{8}$

.10 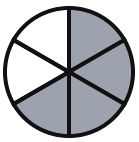

$\frac{4}{6}$

.11 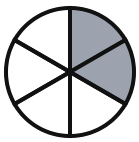

$\frac{2}{6}$

.12 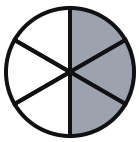

$\frac{3}{6}$

.13 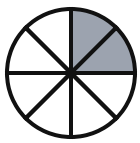

$\frac{2}{8}$

.14 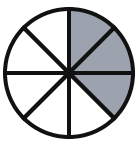

$\frac{3}{8}$

.15 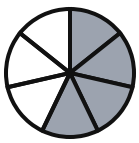

$\frac{4}{7}$

.16 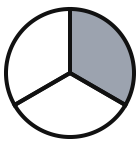

$\frac{1}{3}$

# الكسور المصوّرة

**مفتاح الإجابات**

اكتب الكسر الذي يمثّله الجزء المظلل.

.1 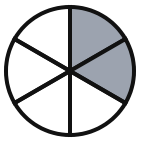

$\frac{2}{6}$

.2 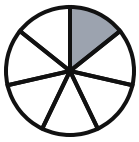

$\frac{1}{7}$

.3 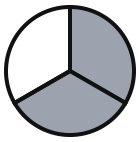

$\frac{2}{3}$

.4 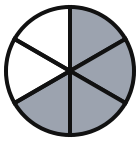

$\frac{4}{6}$

.5 

$\frac{1}{5}$

.6 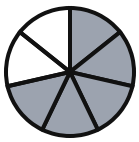

$\frac{5}{7}$

.7 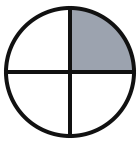

$\frac{1}{4}$

.8 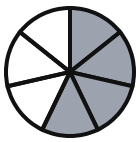

$\frac{4}{7}$

.9 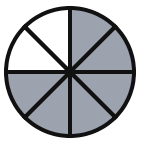

$\frac{6}{8}$

.10 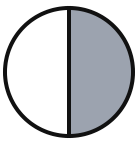

$\frac{1}{2}$

.11 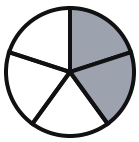

$\frac{2}{5}$

.12 

$\frac{4}{5}$

.13 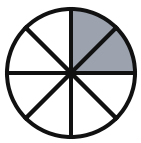

$\frac{2}{8}$

.14 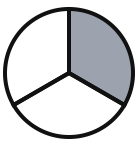

$\frac{1}{3}$

.15 

$\frac{3}{5}$

.16 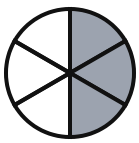

$\frac{3}{6}$